Add Tens and Ones

Check Understanding

Malia counted 33 red blocks and 12 blue blocks. How many blocks did she count?

What You Need

- 2 number cubes (1–6)
- 4 game markers of one color, 4 of another color
- Game Board
- Recording Sheet for each game

What You Do

1. Take turns. Roll the cubes. Find the number next to each toss.
2. Show how to add the numbers on the **Recording Sheet.**
3. Cover the total on the **Game Board** with a game marker. If that number is taken, your turn ends. The player with more markers on the board after 4 turns wins. Play again. Switch who goes first.

Toss	Number
1	14
2	31
3	42
4	23
5	34
6	Lose a Turn

Go Further!

Roll the two number cubes. What is 10 more than the sum?

©Curriculum Associates, LLC
Copying permitted for classroom use.

Player A _____

Player B _____

Add Tens and Ones

46	73	65
28	56	57
54	65	37
84	62	48
45	68	76

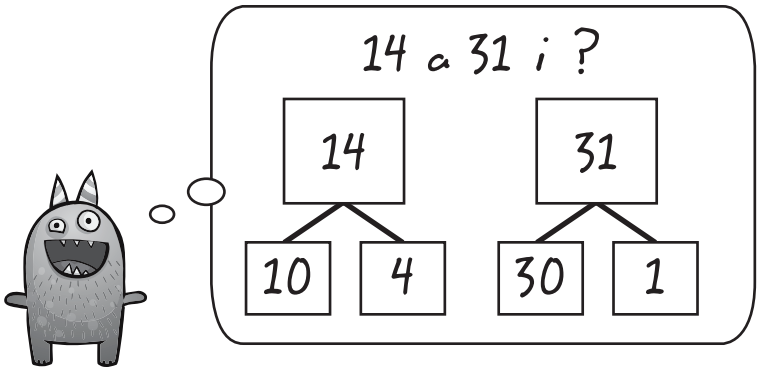

©Curriculum Associates, LLC
Copying permitted for classroom use.

Player A _____

Player B _____

Add Tens and Ones

Player A

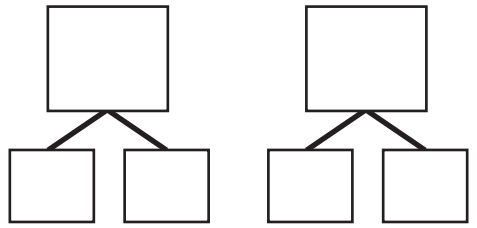

_____ + _____ = _____

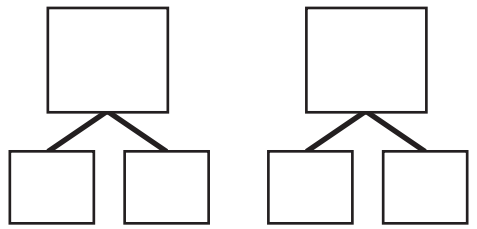

_____ + _____ = _____

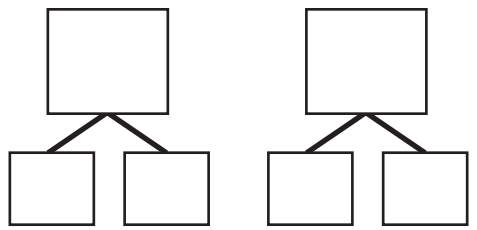

_____ + _____ = _____

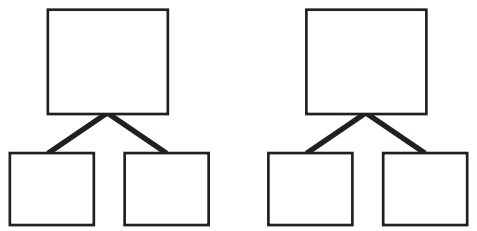

_____ + _____ = _____

Player B

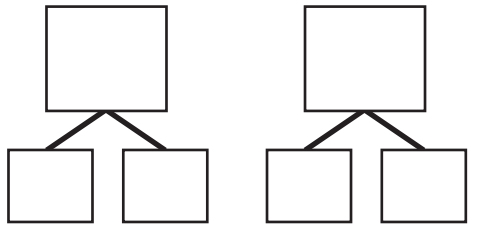

_____ + _____ = _____

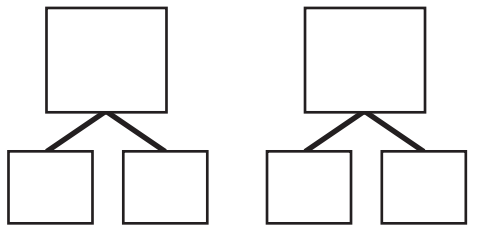

_____ + _____ = _____

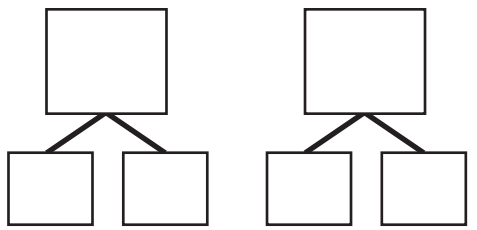

_____ + _____ = _____

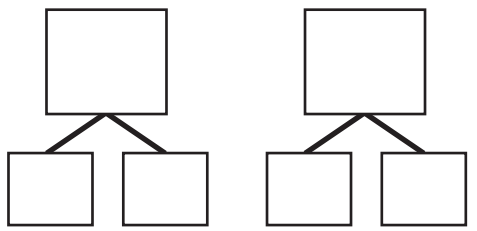

_____ + _____ = _____

©Curriculum Associates, LLC
Copying permitted for classroom use.