Dividing with a Numberline

Name:

Use the numberline to solve each problem.

1) 15 ÷ 3 =

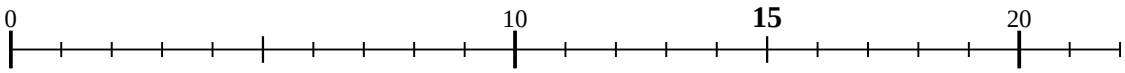

2) 12 ÷ 6 =

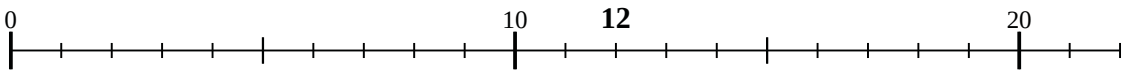

3) 6 ÷ 3 =

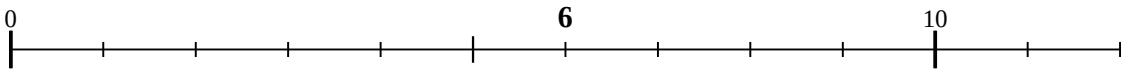

4) 14 ÷ 7 =

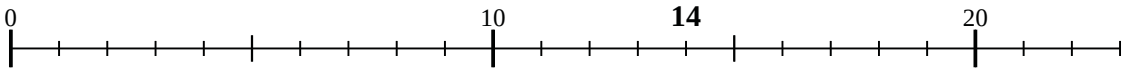

5) 16 ÷ 8 =

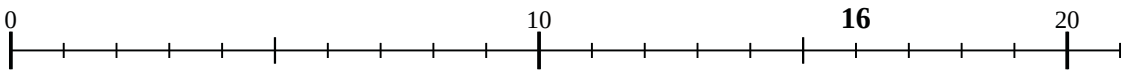

6) 18 ÷ 6 =

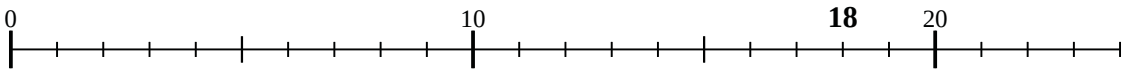

7) 30 ÷ 10 =

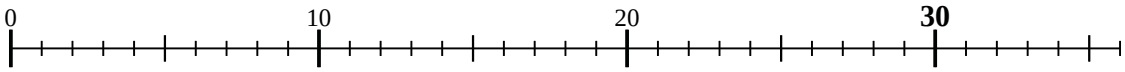

8) 20 ÷ 4 =

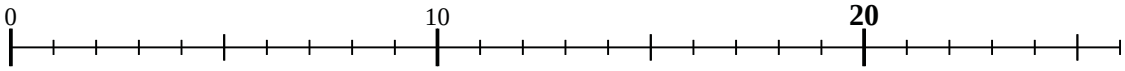

9) 10 ÷ 2 =

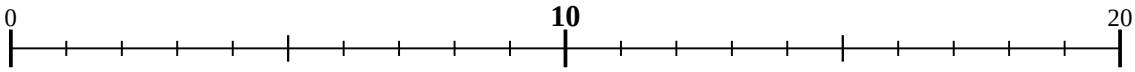

10) 10 ÷ 5 =

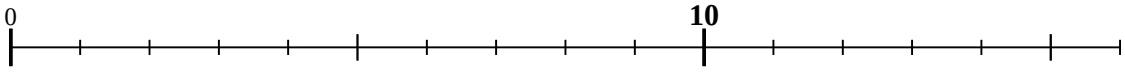

11) 35 ÷ 7 =

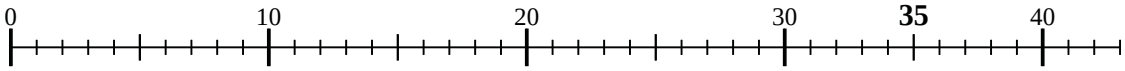

Answers

1. _____
2. _____
3. _____
4. _____
5. _____
6. _____
7. _____
8. _____
9. _____
10. _____
11. _____

1-10	91	82	73	64	55	45	36	27	18	9
11	0									

Dividing with a Numberline

Name: **Answer Key**

Use the numberline to solve each problem.

1) 15 ÷ 3 =

2) 12 ÷ 6 =

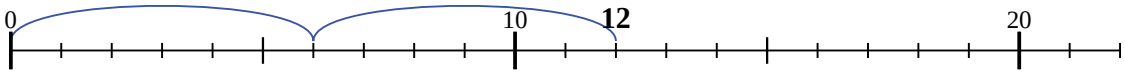

3) 6 ÷ 3 =

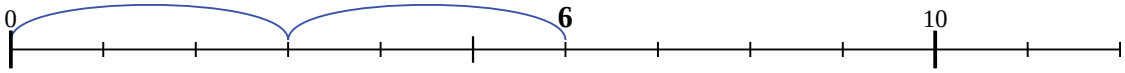

4) 14 ÷ 7 =

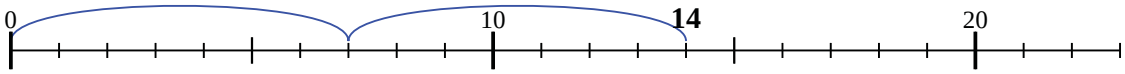

5) 16 ÷ 8 =

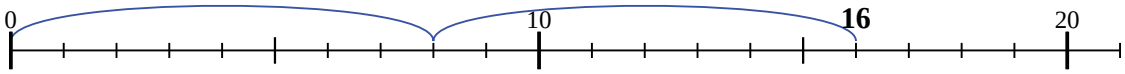

6) 18 ÷ 6 =

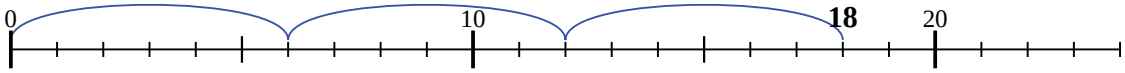

7) 30 ÷ 10 =

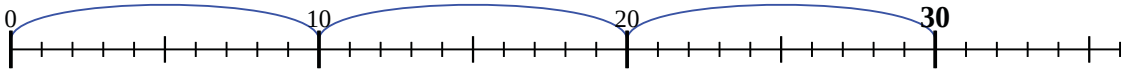

8) 20 ÷ 4 =

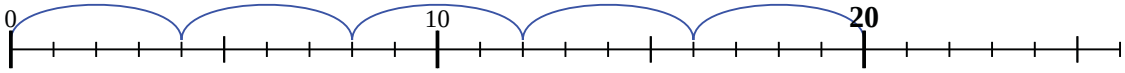

9) 10 ÷ 2 =

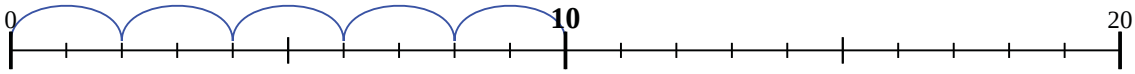

10) 10 ÷ 5 =

11) 35 ÷ 7 =

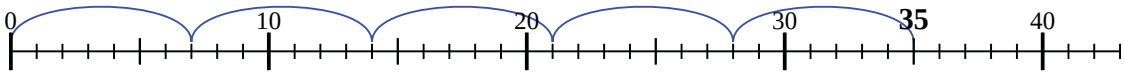

Answers

1. 5
2. 2
3. 2
4. 2
5. 2
6. 3
7. 3
8. 5
9. 5
10. 2
11. 5

1-10	91	82	73	64	55	45	36	27	18	9
11	0									